Number Line Addition

Name _____

Start at the first number. Hop forward to find the answer.

Date _____

1 + 7 = _____

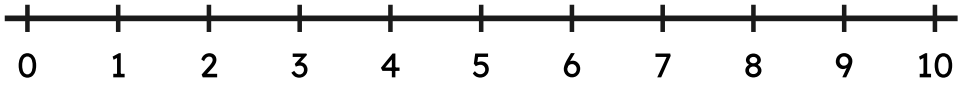

7 + 1 = _____

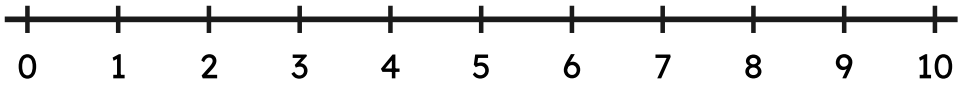

2 + 4 = _____

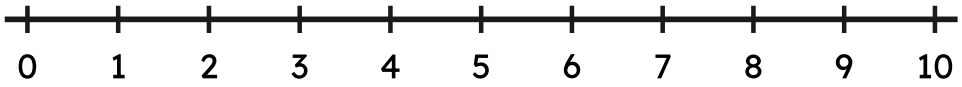

2 + 1 = _____

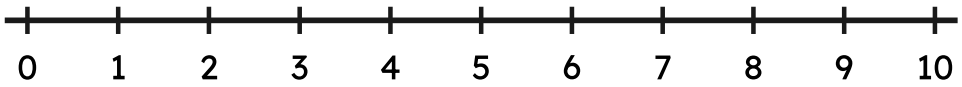

5 + 3 = _____

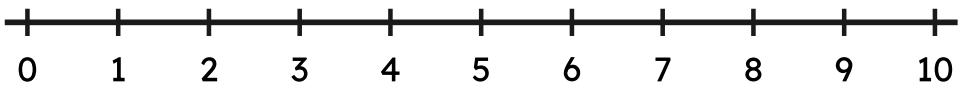

1 + 9 = _____

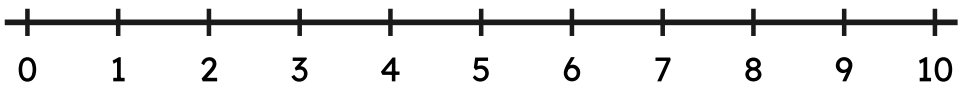

Number Line Addition

Start at the first number. Hop forward to find the answer.

ANSWER KEY

1 + 7 = **8**

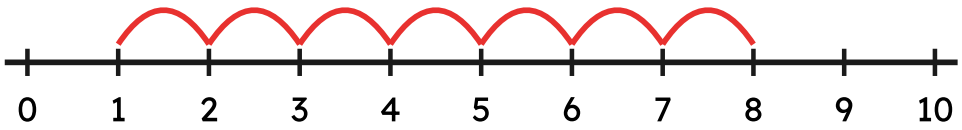

7 + 1 = **8**

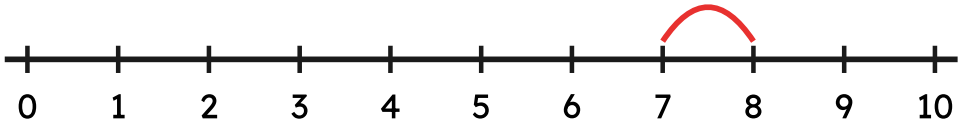

2 + 4 = **6**

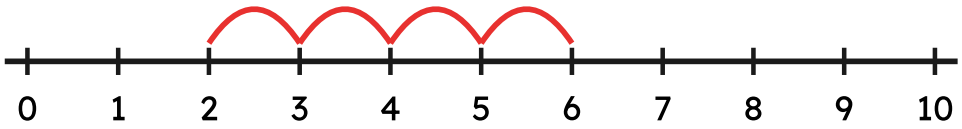

2 + 1 = **3**

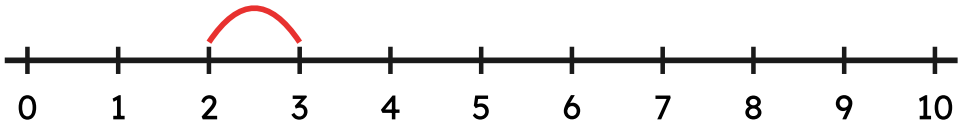

5 + 3 = **8**

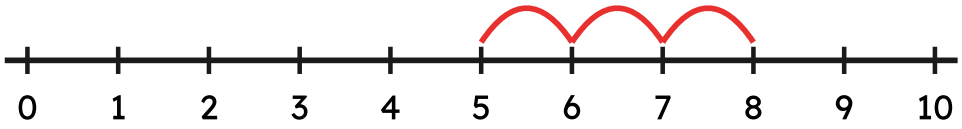

1 + 9 = **10**

