Number Line Addition

Name _____

Start at the first number. Hop forward to find the answer.

Date _____

4 + 2 = _____

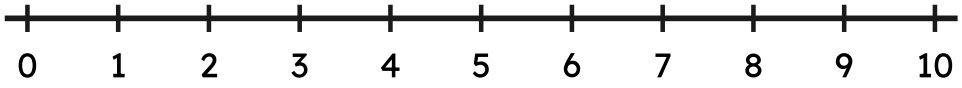

5 + 1 = _____

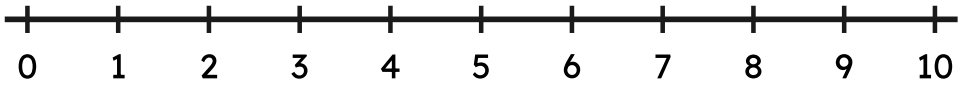

4 + 6 = _____

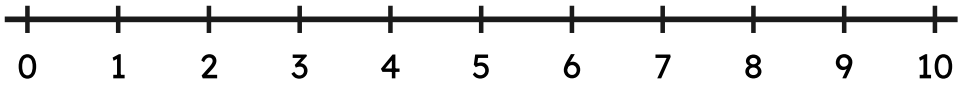

6 + 3 = _____

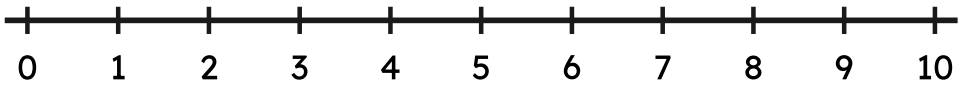

1 + 8 = _____

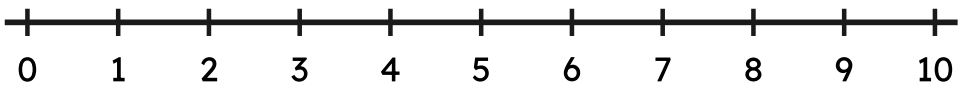

5 + 3 = _____

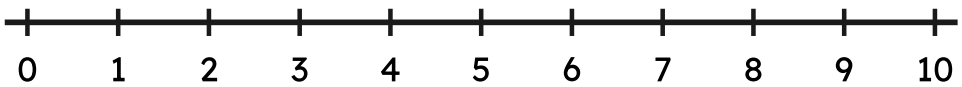

Number Line Addition

Start at the first number. Hop forward to find the answer.

ANSWER KEY

4 + 2 = **6**

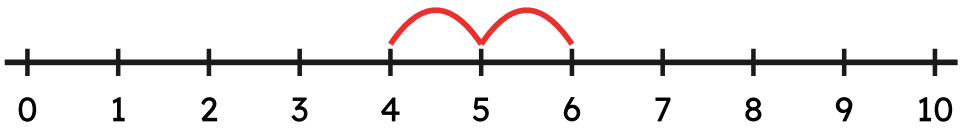

5 + 1 = **6**

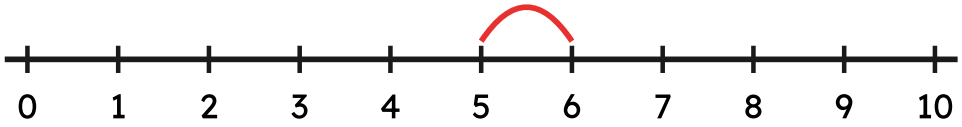

4 + 6 = **10**

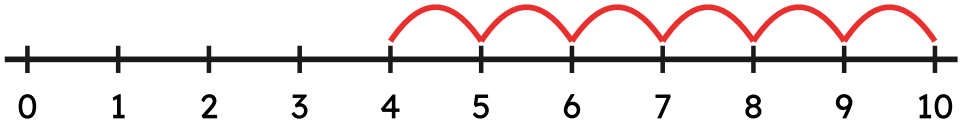

6 + 3 = **9**

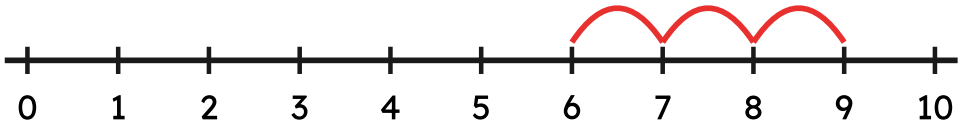

1 + 8 = **9**

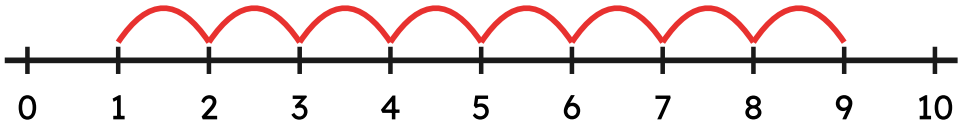

5 + 3 = **8**

