Number Line Addition

Name _____

Start at the first number. Hop forward to find the answer.

Date _____

4 + 6 = _____

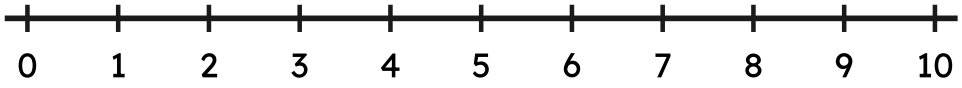

2 + 6 = _____

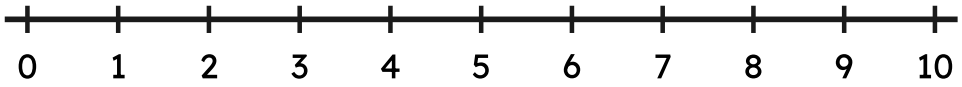

3 + 3 = _____

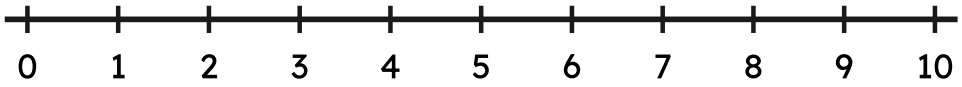

3 + 4 = _____

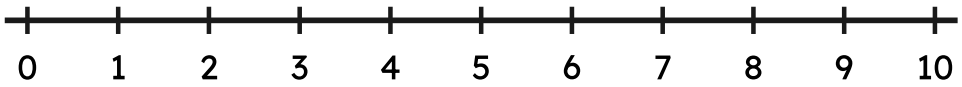

2 + 2 = _____

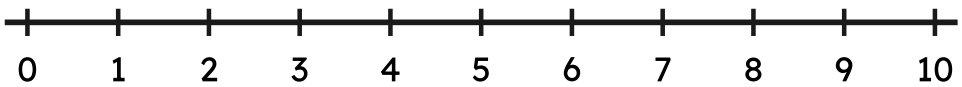

1 + 1 = _____

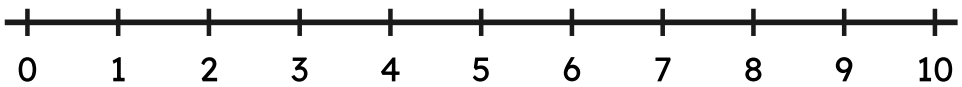

Number Line Addition

Start at the first number. Hop forward to find the answer.

ANSWER KEY

4 + 6 = **10**

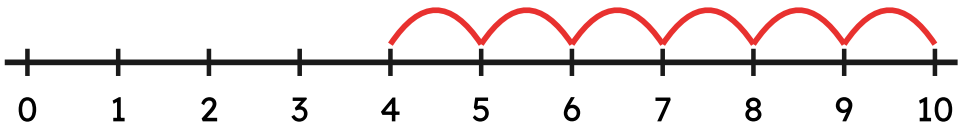

2 + 6 = **8**

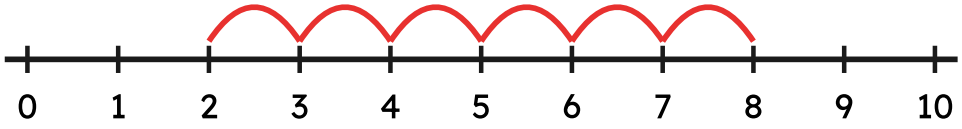

3 + 3 = **6**

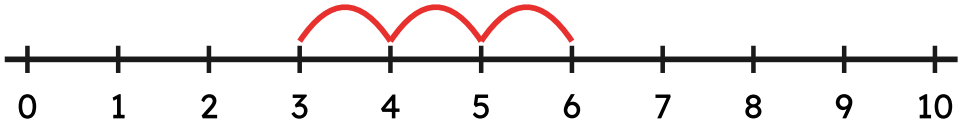

3 + 4 = **7**

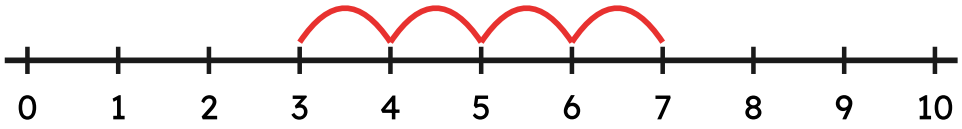

2 + 2 = **4**

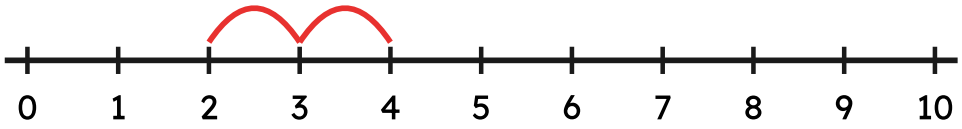

1 + 1 = **2**

