Number Line Addition

Name _____

Start at the first number. Hop forward to find the answer.

Date _____

1 + 5 = _____

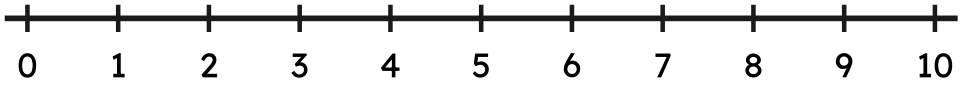

1 + 3 = _____

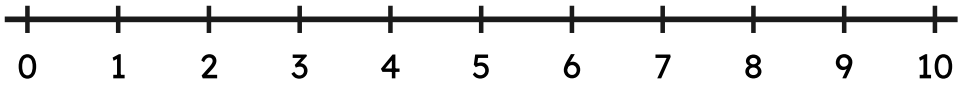

3 + 2 = _____

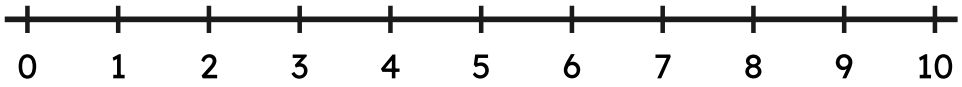

8 + 2 = _____

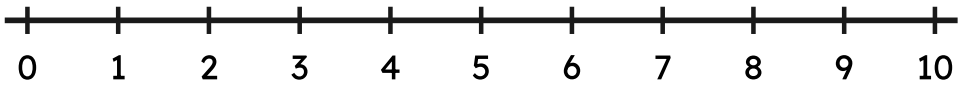

6 + 3 = _____

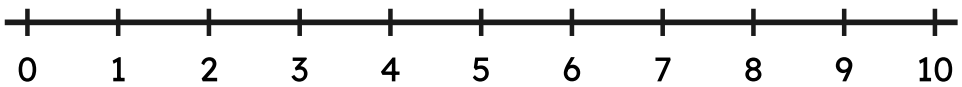

4 + 4 = _____

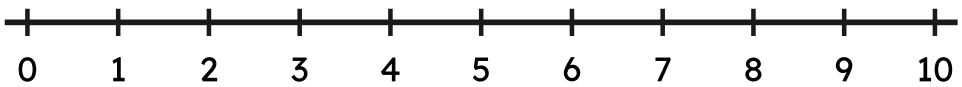

Number Line Addition

Start at the first number. Hop forward to find the answer.

ANSWER KEY

1 + 5 = **6**

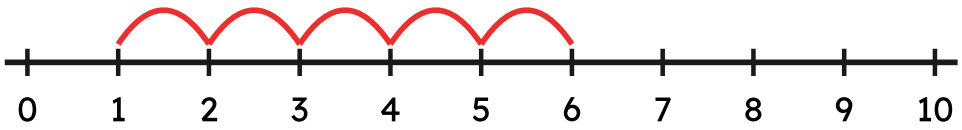

1 + 3 = **4**

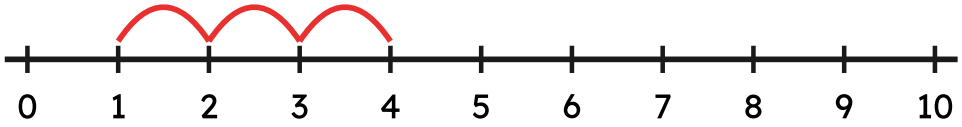

3 + 2 = **5**

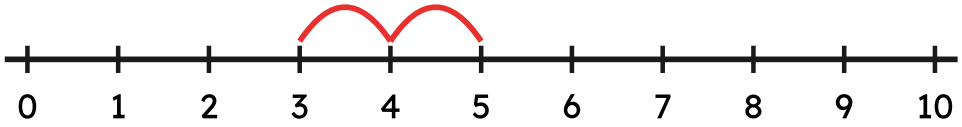

8 + 2 = **10**

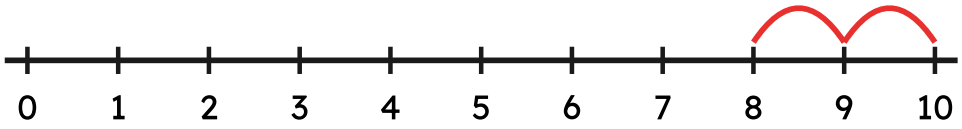

6 + 3 = **9**

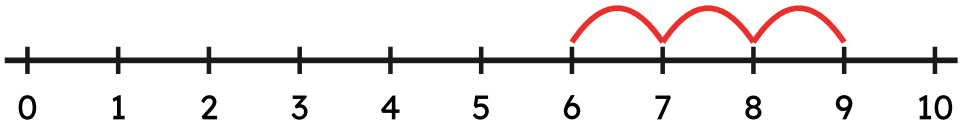

4 + 4 = **8**

