Number Line Subtraction

Start at the first number. Hop back to find the answer.

Name _____

Date _____

10 − 8 = _____

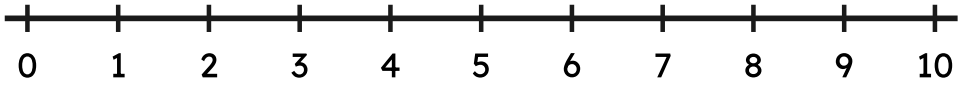

10 − 2 = _____

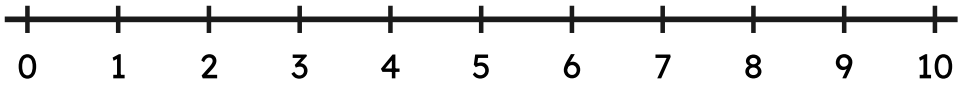

2 − 1 = _____

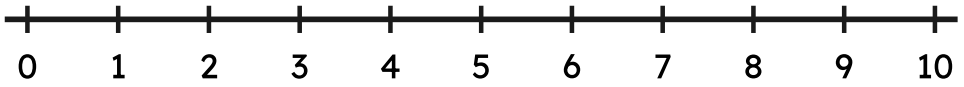

10 − 5 = _____

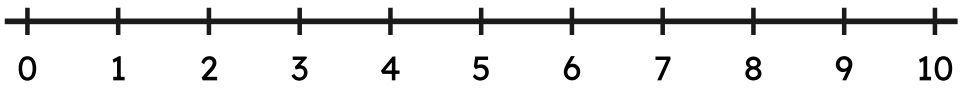

5 − 5 = _____

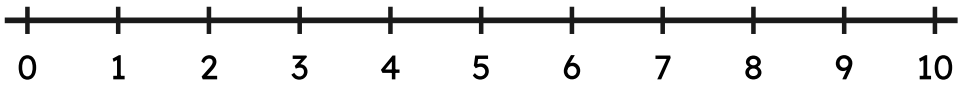

7 − 1 = _____

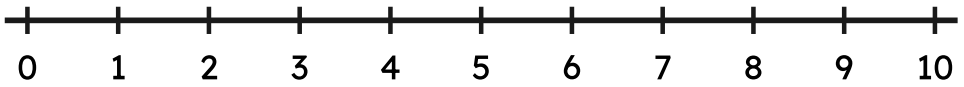

Number Line Subtraction

Start at the first number. Hop back to find the answer.

ANSWER KEY

10 − 8 = **2**

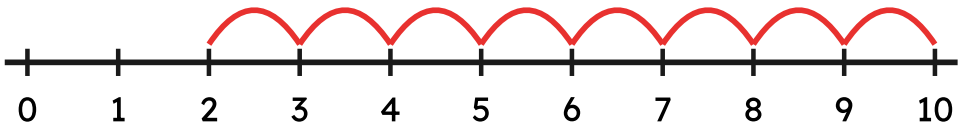

10 − 2 = **8**

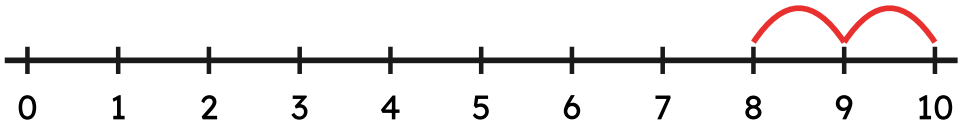

2 − 1 = **1**

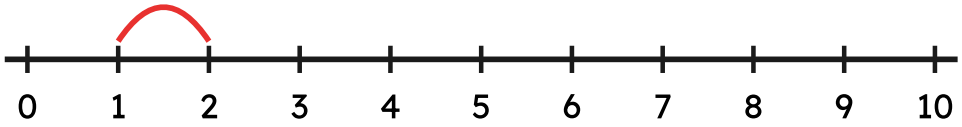

10 − 5 = **5**

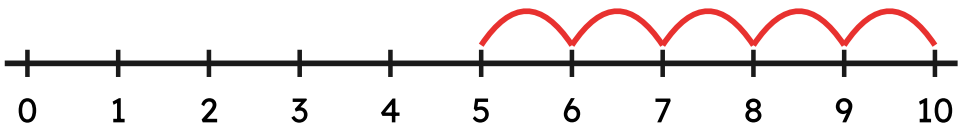

5 − 5 = **0**

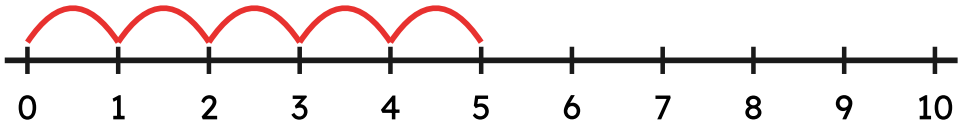

7 − 1 = **6**

