Number Line Subtraction

Start at the first number. Hop back to find the answer.

Name _____

Date _____

6 − 2 = _____

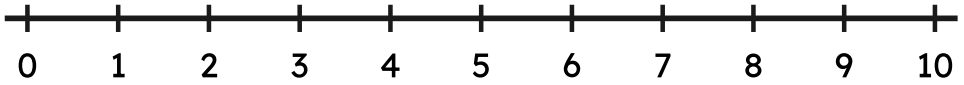

3 − 2 = _____

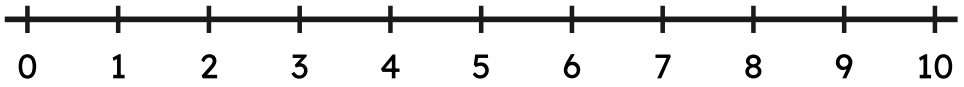

10 − 10 = _____

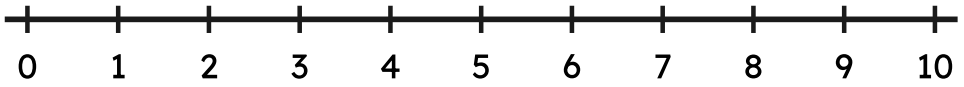

10 − 2 = _____

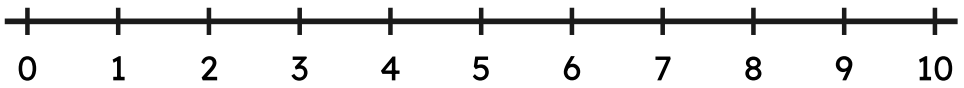

8 − 1 = _____

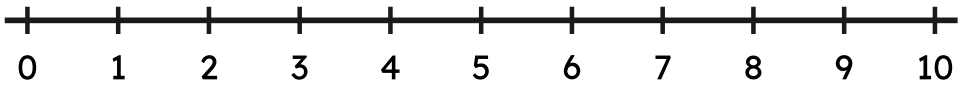

5 − 4 = _____

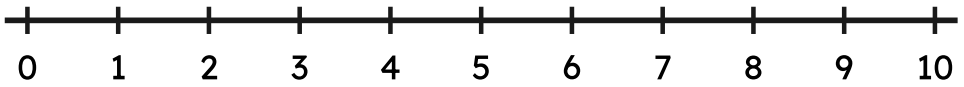

Number Line Subtraction

Start at the first number. Hop back to find the answer.

ANSWER KEY

6 − 2 = **4**

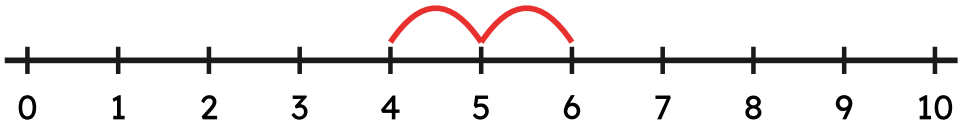

3 − 2 = **1**

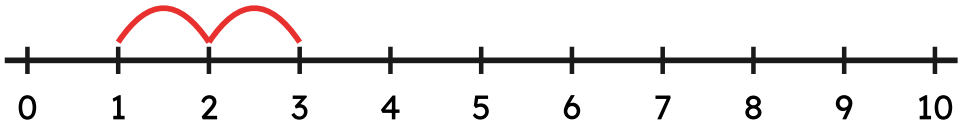

10 − 10 = **0**

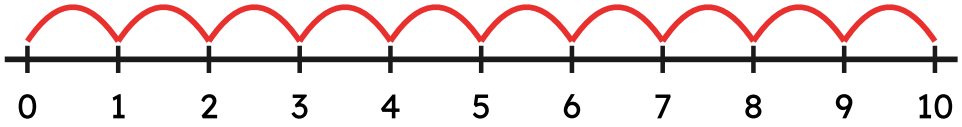

10 − 2 = **8**

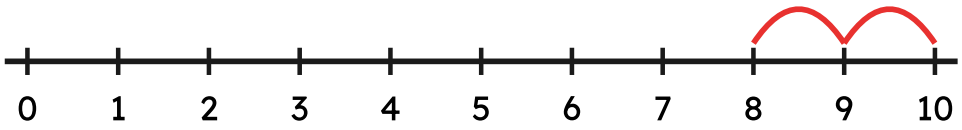

8 − 1 = **7**

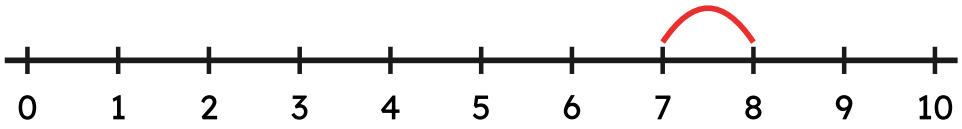

5 − 4 = **1**

