Number Line Subtraction

Start at the first number. Hop back to find the answer.

Name _____

Date _____

5 − 4 = _____

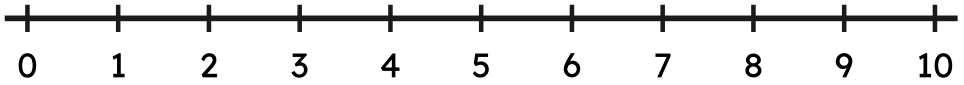

5 − 5 = _____

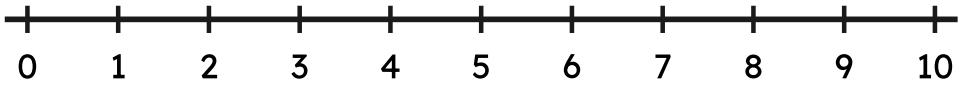

3 − 2 = _____

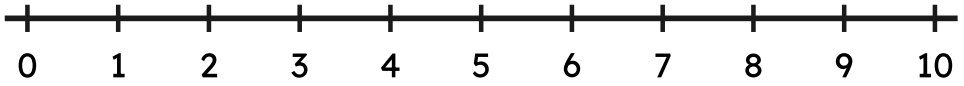

10 − 10 = _____

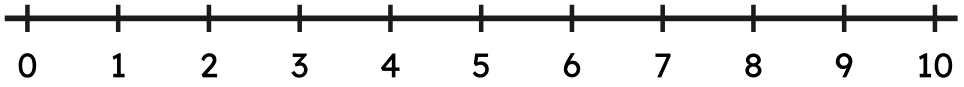

10 − 6 = _____

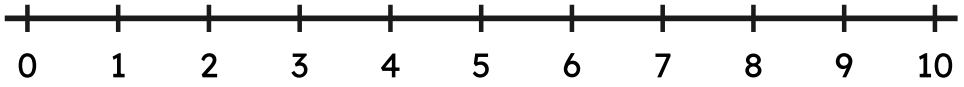

8 − 3 = _____

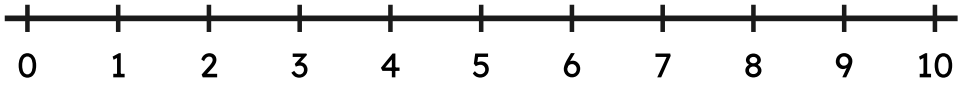

Number Line Subtraction

Start at the first number. Hop back to find the answer.

ANSWER KEY

5 − 4 = **1**

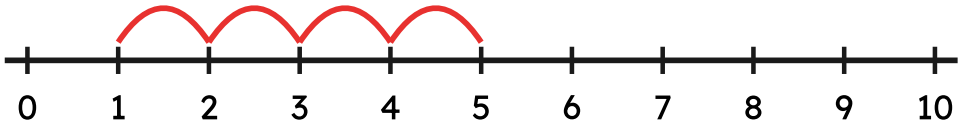

5 − 5 = **0**

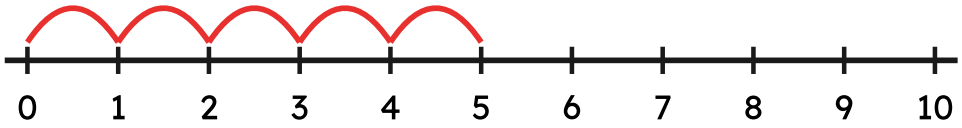

3 − 2 = **1**

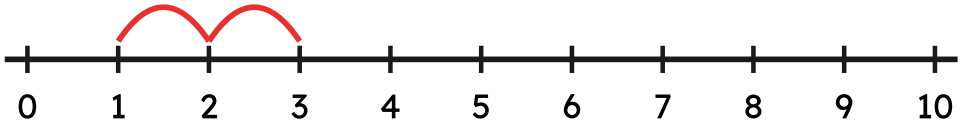

10 − 10 = **0**

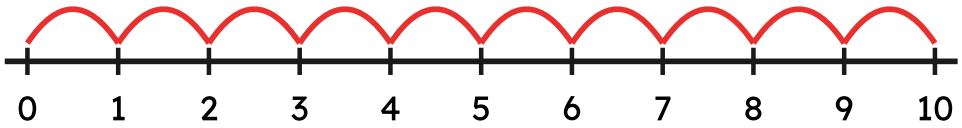

10 − 6 = **4**

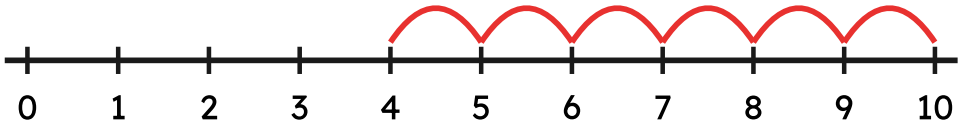

8 − 3 = **5**

